Unidad 6, Lección 11

Contemos imágenes (parte 1)

Encontremos 10 figuras y contémoslas.

 CC BY NC 2024
Illustrative Mathematics®

Actividad 1

Busquemos 10 para contar

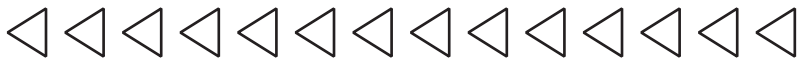

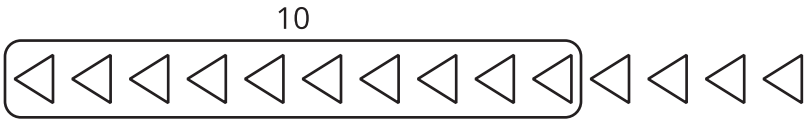

1.

_____ cuadrados

2.



_____ rectángulos

3.

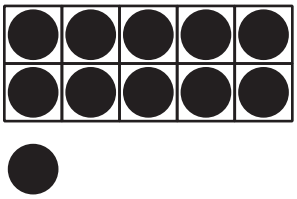

_____ puntos

4.

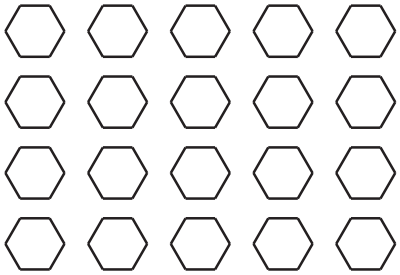

_____ hexágonos

5.



_____ puntos

6.



_____ triángulos

Actividad 2

Coloreemos para que corresponda a las expresiones

1. Colorea los cuadrados para mostrar $10 + 2$.



$10 + 2 =$ _____

 CC BY NC 2024
Illustrative Mathematics®

2. Colorea los triángulos para mostrar $10 + 8$.

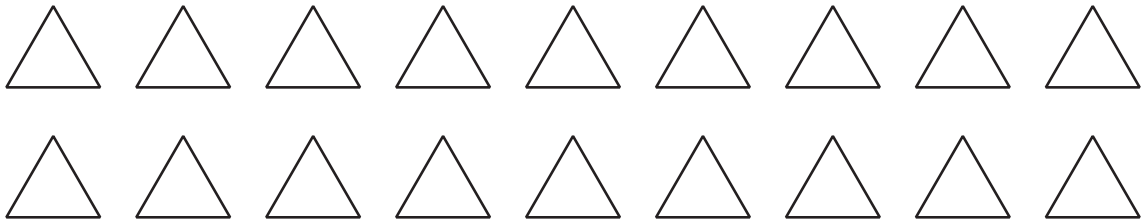

$10 + 8 =$ _____

3. Colorea los hexágonos para mostrar $10 + 4$.

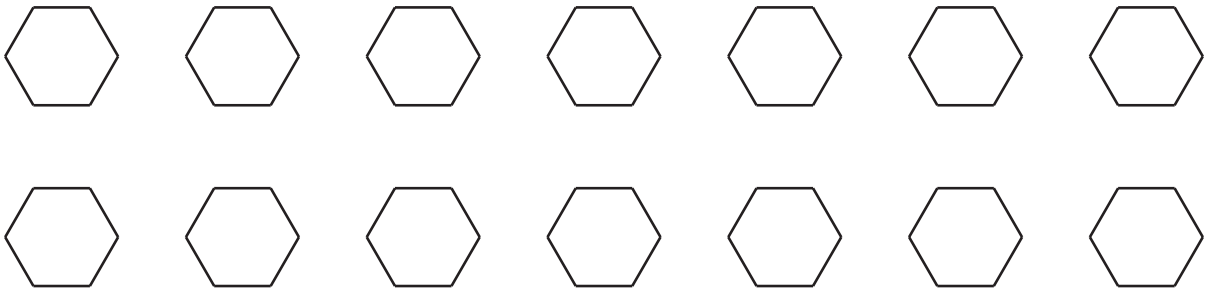

$10 + 4 =$ _____

 CC BY NC 2024
Illustrative Mathematics®

4. Colorea los círculos para mostrar $10 + 9$.

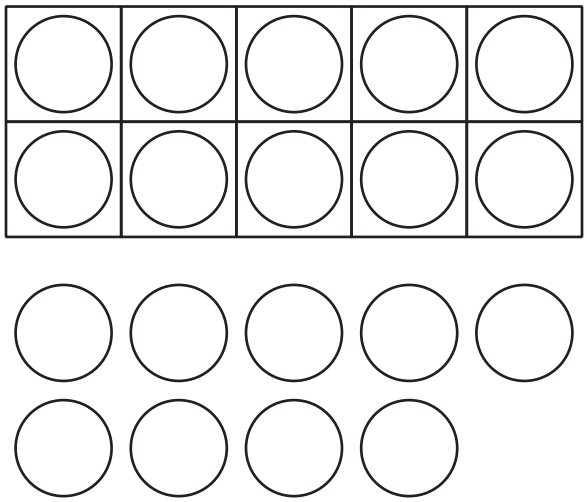

$10 + 9 =$ _____

 CC BY NC 2024
Illustrative Mathematics®

Actividad 3

Centros: Momento de escoger

Escoge un centro.

Encuentra el valor de las expresiones

Formar o separar números

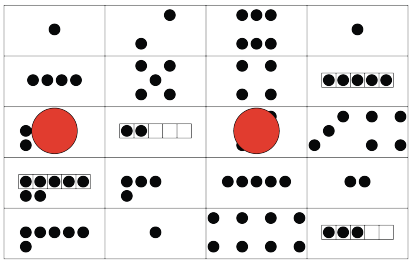

Bingo

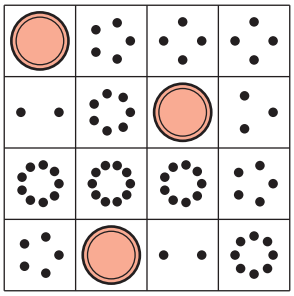

 CC BY NC 2024
Illustrative Mathematics®