Unit 4, Lesson 2

Count 2 Groups of Images

Let's count things in 2 groups.

Activity 1

Put Together Dots on 5-Frames

There are _____ dots.

There are _____ dots.

There are _____ dots.

There are _____ dots.

There are _____ dots.

Activity 2

How Many Apples?

1.



_____

There are _____ apples.

2.



_____

There are _____ apples.

3.



_____

- - - - - - - - - - - - - - - - - -

There are _____ apples.

4.



_____

- - - - - - - - - - - - - - - - - -

There are _____ apples.

Activity 3

Introduce Roll and Add—Dots

Choose a center.

Roll and Add

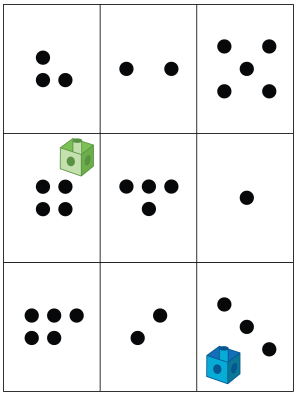

Match Mine

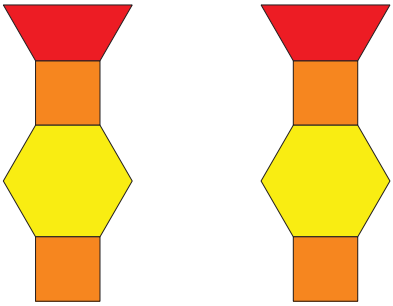

Math Libs



Tower Build

