Unit 4, Lesson 3

Count 2 Groups of Scattered Images

Let's count things in 2 groups.

Activity 1

Count Organized and Scattered Images

1.



_____

There are _____ balls.

2.

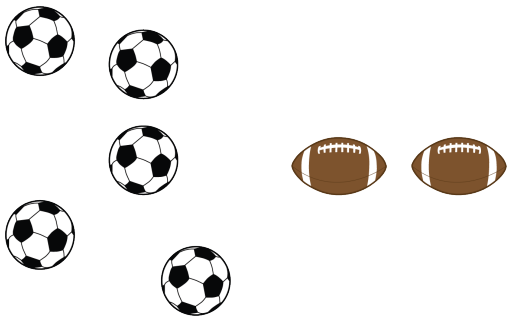

_____

There are _____ balls.

3.



There are _____ balls.

4.



There are _____ balls.

Activity 2

Count Scattered Images

1.

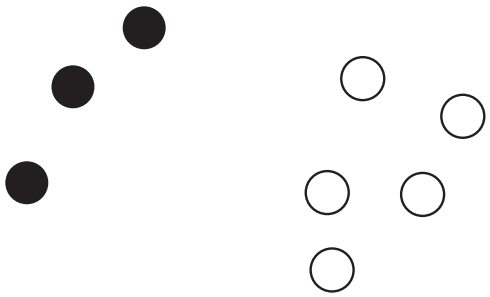

There are _____ circles.

2.

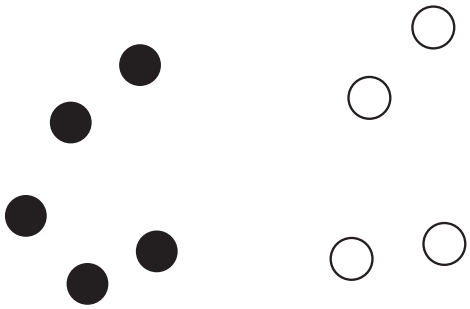

There are _____ circles.

3.

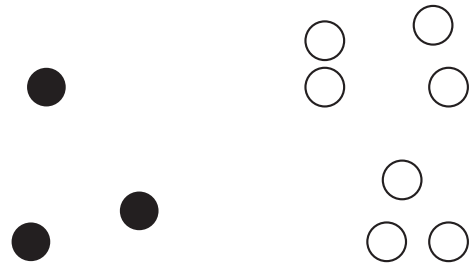

There are _____ circles.

4.



There are _____ circles.

Activity 3

Centers: Choice Time

Choose a center.

Roll and Add

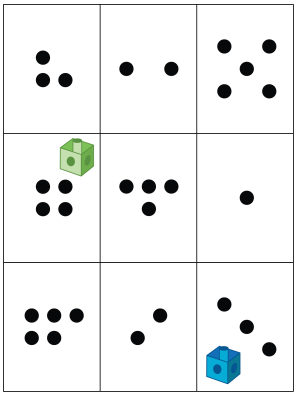

Match Mine

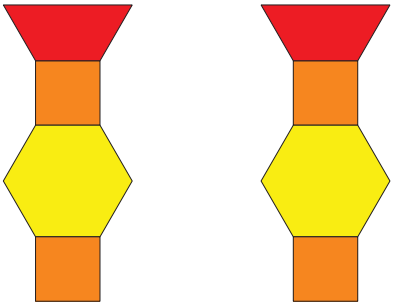

Math Libs



Tower Build

