Unit 4, Lesson 1

Whole Numbers on the Number Line

Let's represent numbers on a number line.

Warm-up

Notice and Wonder: Rulers and Number Lines

What do you notice? What do you wonder?

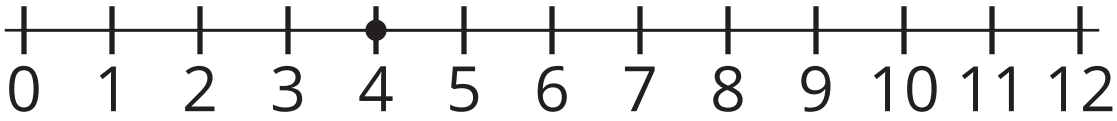

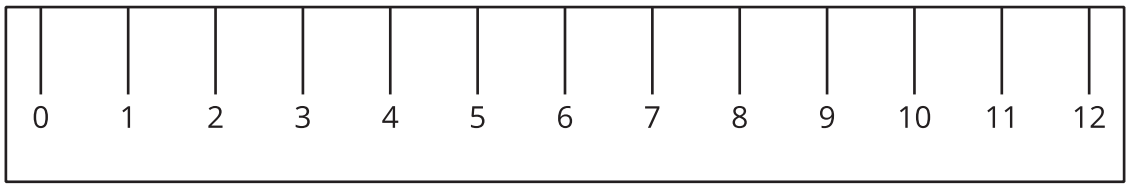

Activity 1

What Is a Number Line?

1. Label each tick mark with the number it represents.

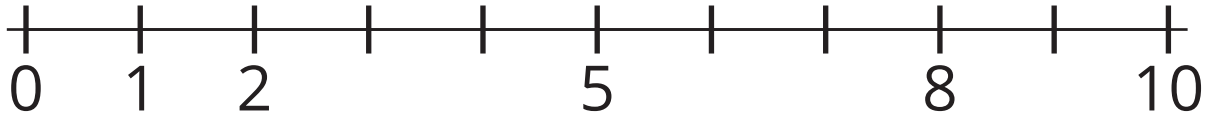

2. Locate 6. Mark it with a point.

3. Locate a number that is greater than 6. Mark it with a point.

4. Label each tick mark with the number it represents.

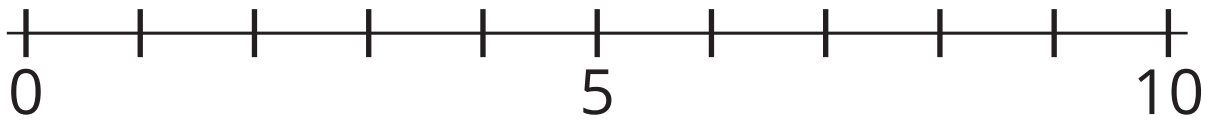

5. Locate 9. Mark it with a point.

6. Locate a number that is less than 9. Mark it with a point.

Activity 2

Make Your Own Number Line

1. Make a number line that goes from 0 to 20.
2. Locate 13. Mark it with a point.
3. Locate 3. Mark it with a point.
4. Compare number lines with your partner.