Unit 3, Lesson 13

Benchmark Percentages

Let's contrast percentages and fractions.

13.1 Which Three Go Together: Shaded Diagram

Which three go together? Why do they go together?

A

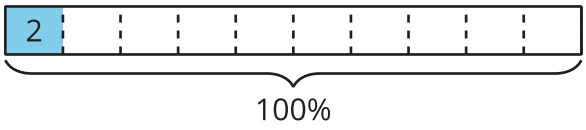

B

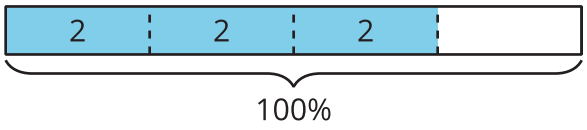

C

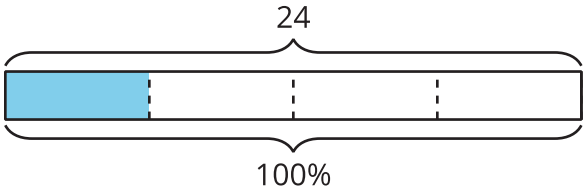

D

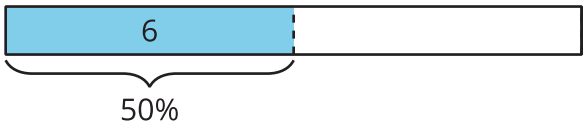

CC BY NC Illustrative Mathematics, based on IM 6–8 Math, CC BY Open Up Resources.

13.2 Liters, Meters, and Hours

1. a. How much is 50% of 10 liters of milk?

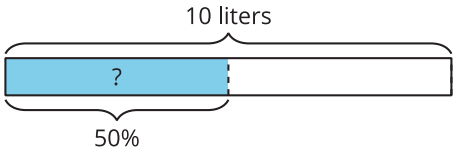

   b. How far is 50% of a 2,000-kilometer trip?

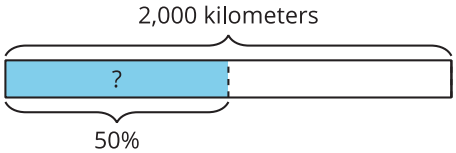

   c. How long is 50% of a 24-hour day?

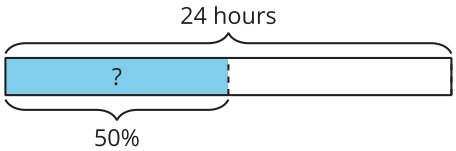

   d. How can you find 50% of any number?

2. a. How far is 10% of a 2,000-kilometer trip?

   b. How much is 10% of 10 liters of milk?

   c. How long is 10% of a 24-hour day?

   d. How can you find 10% of any number?

3. a. How long is 75% of a 24-hour day?

   b. How far is 75% of a 2,000-kilometer trip?

   c. How much is 75% of 10 liters of milk?

   d. How can you find 75% of any number?

CC BY NC Illustrative Mathematics, based on IM 6–8 Math, CC BY Open Up Resources.

13.3 Nine Is . . .

Calculate each value mentally. Be prepared to explain your reasoning.

1. 9 is 50% of what number?

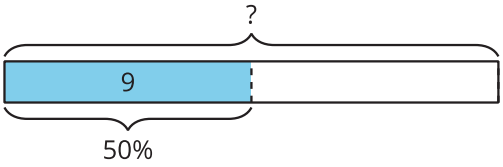

2. 9 is 25% of what number?

3. 9 is 10% of what number?

4. 9 is 75% of what number?

5. 9 is 150% of what number?

CC BY NC Illustrative Mathematics, based on IM 6–8 Math, CC BY Open Up Resources.

13.4 Shopping with Coupons

Han and Clare go shopping, and they each have a coupon.

1. Han buys an item with a normal price of $15, and uses a 10% off coupon. How much does he save by using the coupon? Show your reasoning.

2. Clare buys an item with a normal price of $24, but saves $6 by using a coupon. For what percentage off is this coupon? Show your reasoning.

Are you ready for more?

Clare paid full price for an item. Han bought the same item for 80% of the full price. Clare said, “I can’t believe I paid 125% of what you paid, Han!” Is what she said true? Explain your reasoning.

CC BY NC Illustrative Mathematics, based on IM 6–8 Math, CC BY Open Up Resources.

Lesson 13 Summary

Certain percentages are easy to think about in terms of fractions.

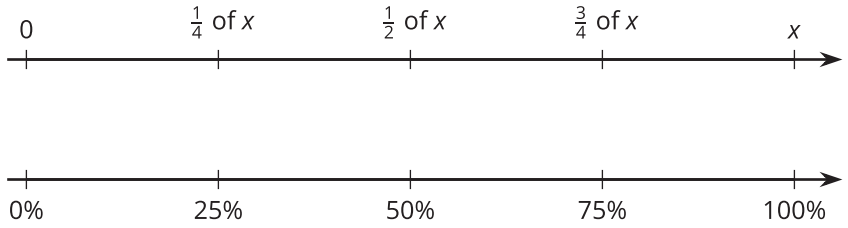

- 25% of a number is always $\frac{1}{4}$ of that number. For example, 25% of 40 liters is $\frac{1}{4} \cdot 40$, or 10 liters.
- 50% of a number is always $\frac{1}{2}$ of that number. For example, 50% of 82 kilometers is $\frac{1}{2} \cdot 82$, or 41 kilometers.
- 75% of a number is always $\frac{3}{4}$ of that number. For example, 75% of 1 pound is $\frac{3}{4}$ pound.
- 10% of a number is always $\frac{1}{10}$ of that number. For example, 10% of 95 meters is 9.5 meters.

We can also find multiples of 10% using tenths. For example, 70% of a number is always $\frac{7}{10}$ of that number, so 70% of 30 days is $\frac{7}{10} \cdot 30$, or 21 days.

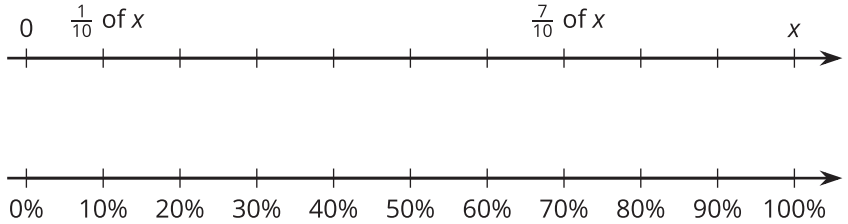

CC BY NC Illustrative Mathematics, based on IM 6–8 Math, CC BY Open Up Resources.