Directions:

- Remove the cards that show 10. Set them aside.
- Each partner:
  - Take 5 cards.
  - Choose 3 numbers.
  - Write an equation to show the sum of the 3 numbers.
  - Compare sums. The partner who is closer to 20 wins a point.
- Take 3 new cards. Start the next round.

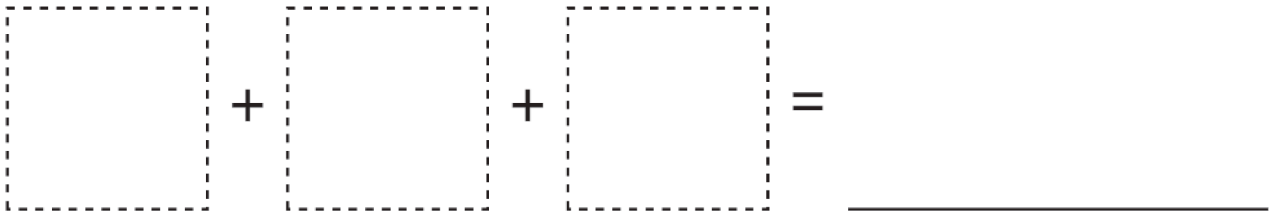

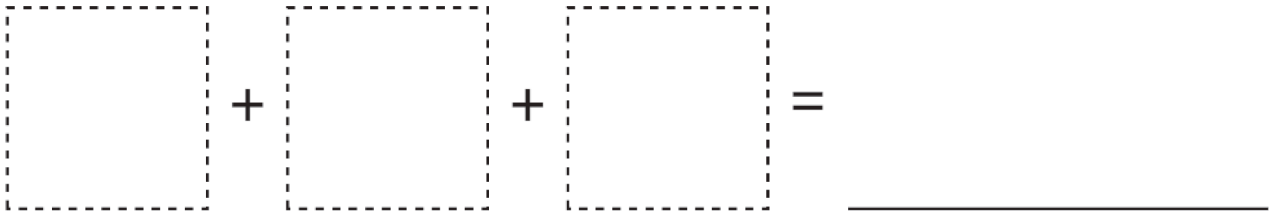

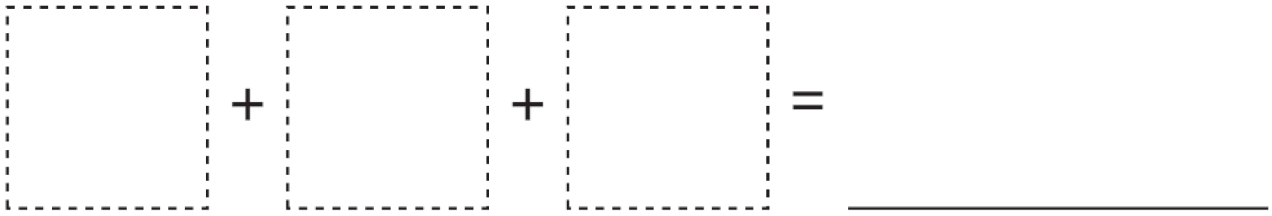

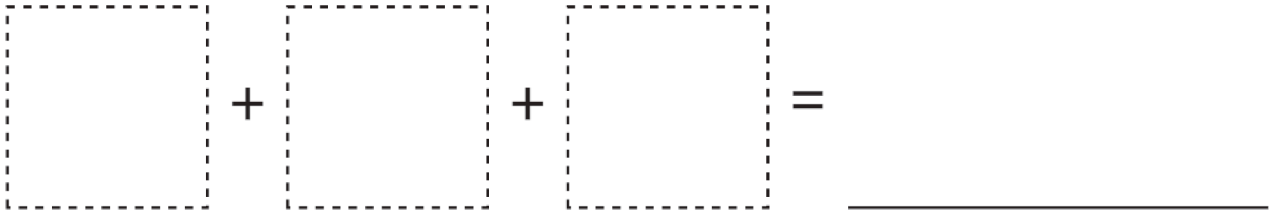



1	2
3	4
5	6

CC BY NC 2024 Illustrative Mathematics®

7	8
9	1
2	3

CC BY NC 2024 Illustrative Mathematics®

4	5
6	7
8	9

CC BY NC 2024 Illustrative Mathematics®

0	0
10	10

Directions:

- Remove the cards that show 10. Set them aside.
- Each partner:
  - Take 4 cards.
  - Choose 2 or 3 numbers to subtract from 20.
  - Write an equation to show the difference when subtracting the numbers from 20.
  - Compare differences. The partner who is closer to 0 wins a point.
- Take 2 or 3 new cards. Start the next round.

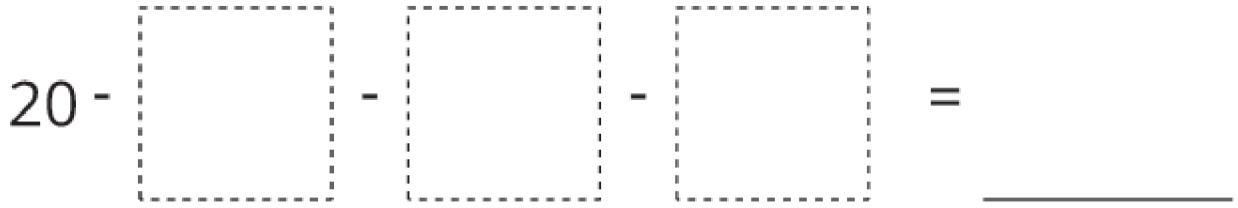

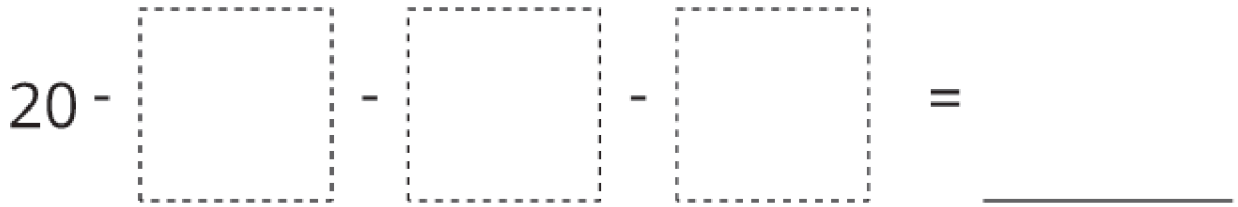

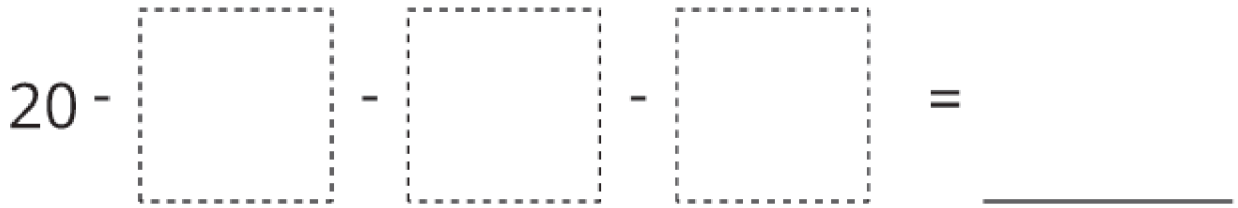

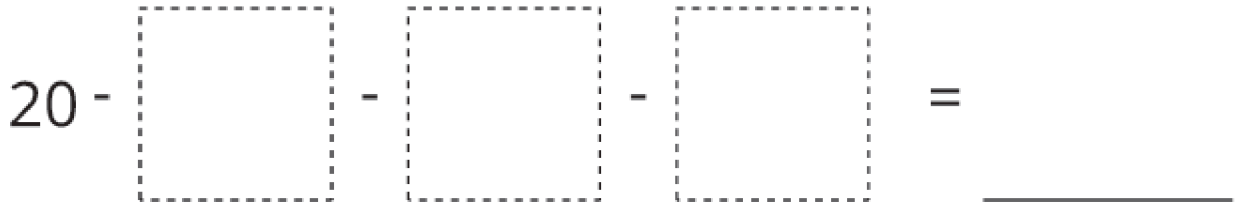

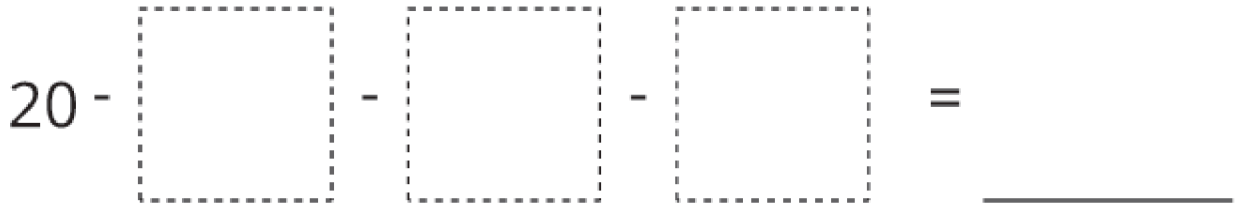

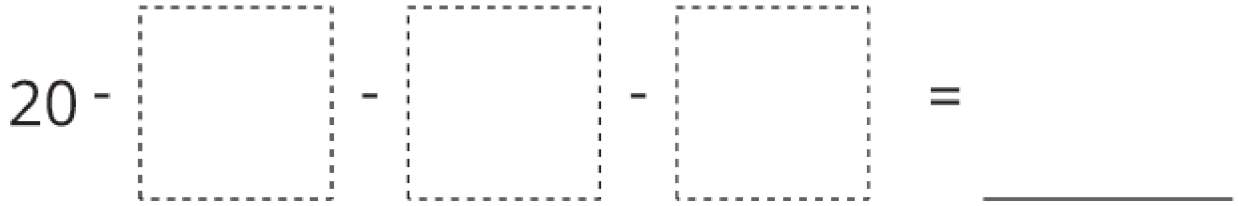

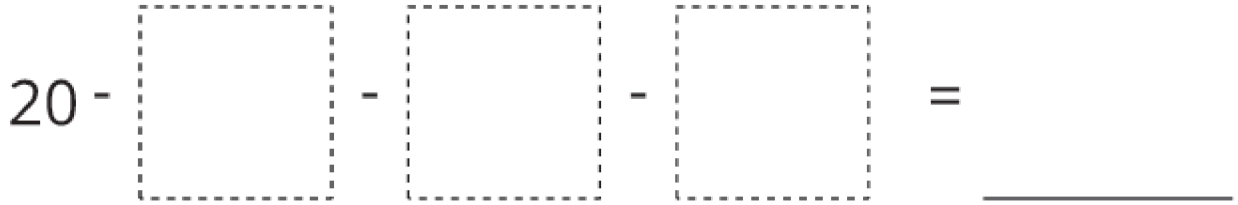

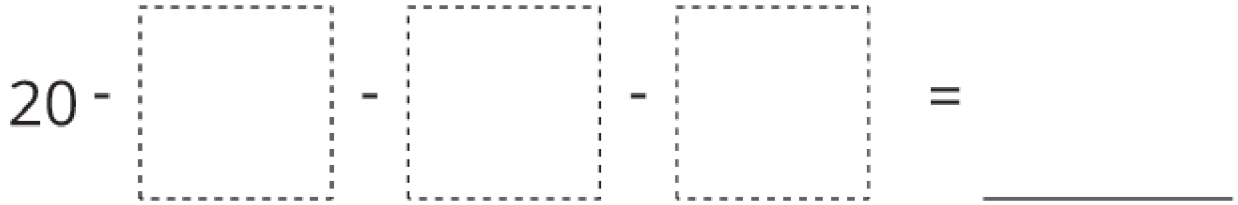

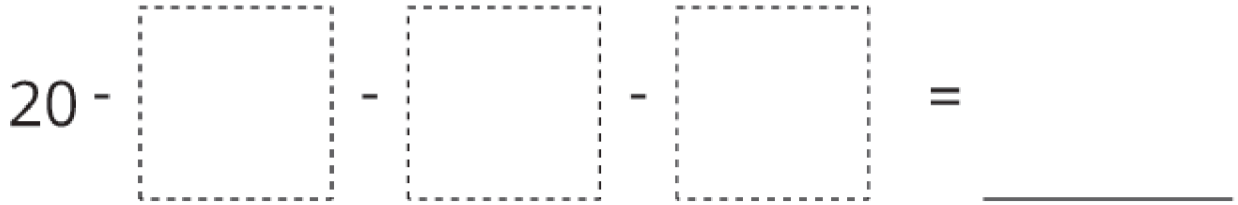

CC BY NC 2024 Illustrative Mathematics®

1	2
3	4
5	6

CC BY NC 2024 Illustrative Mathematics®

7	8
9	1
2	3

CC BY NC 2024 Illustrative Mathematics®

4	5
6	7
8	9

CC BY NC 2024 Illustrative Mathematics®

0	0
10	10

Directions:

- Remove the cards that show 10. Set them aside.
- Each partner:
  - Take 7 cards.
  - Choose 4 cards. Make 2 two-digit numbers.
  - Write an equation to show the sum of the numbers you made.
  - Compare sums with your partner. The partner that is closer to 100 wins a point.
- Take 4 new cards. Start the next round.

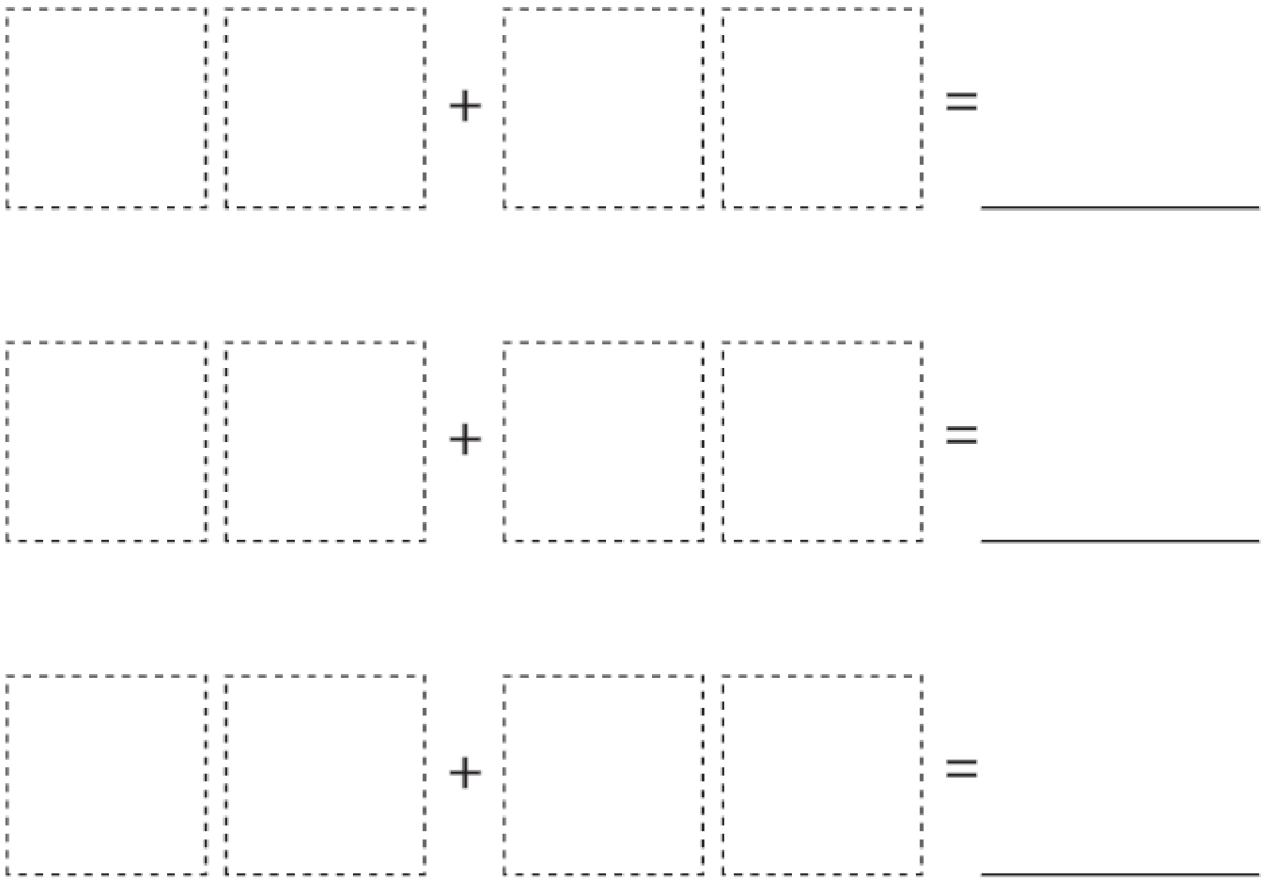











1	2
3	4
5	6

CC BY NC 2024 Illustrative Mathematics®

7	8
9	1
2	3

4	5
6	7
8	9

CC BY NC 2024 Illustrative Mathematics®

0	0
10	10

Directions:

- Remove the cards that show 10. Set them aside.
- Each partner:
  - Take 8 cards.
  - Choose 6 cards to make 2 three-digit numbers.
  - Write an equation to show the sum of the numbers you made.
  - Your score for each round is the difference between your sum and 1,000.
- Take 6 new cards. Start the next round.
- Add your score for each round. The partner with the lower score wins.

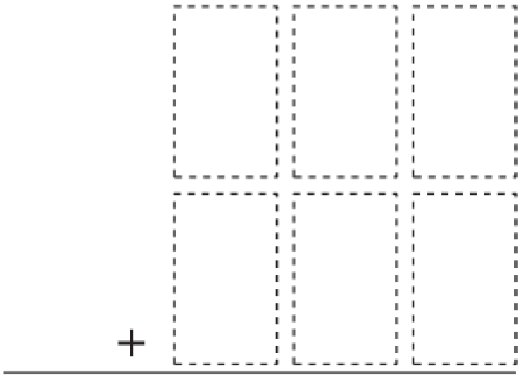

Your score this round:_____

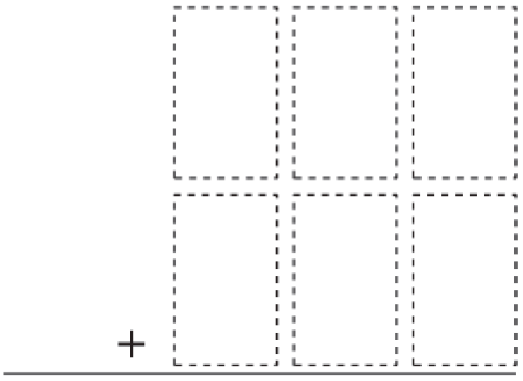

Your score this round:_____

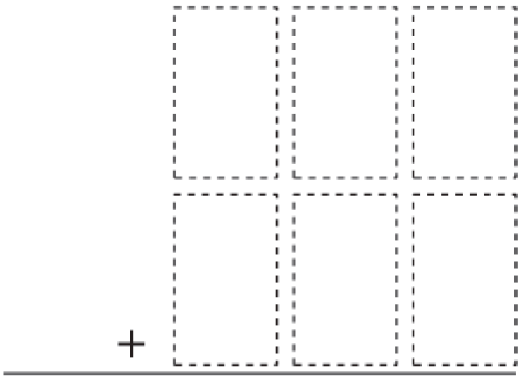

Your score this round:_____

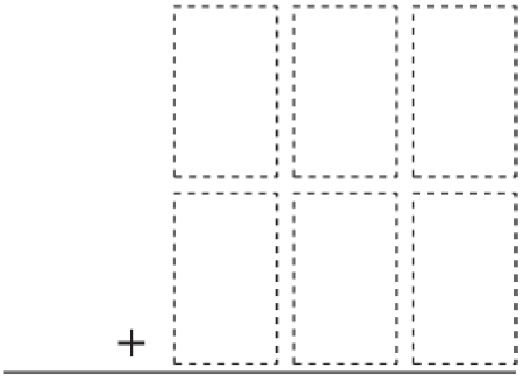

Your score this round:_____

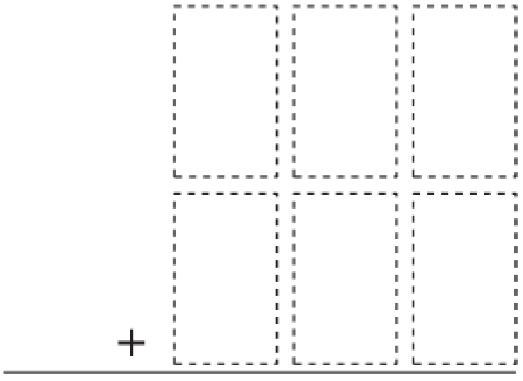

Your score this round:_____

1	2
3	4
5	6

CC BY NC 2024 Illustrative Mathematics®

7	8
9	1
2	3

CC BY NC 2024 Illustrative Mathematics®

4	5
6	7
8	9

CC BY NC 2024 Illustrative Mathematics®

0	0
10	10

Directions:

- Remove the cards that show 10 and set them aside.
- Each partner:
  - Take 4 cards.
  - Choose 2–3 cards to multiply.
  - Write an equation to show the product of the numbers you chose.
  - Your score for each round is the difference between your product and 100.
- Take new cards so that you have 4 cards to start the next round.
- At the end of the game, add your score for each round. The partner with the lower score wins.

round	multiplication equation	points for the round
1		
2		
3		
4		
5		
6		
7		
8		

1	2
3	4
5	6

CC BY NC 2024 Illustrative Mathematics®

7	8
9	1
2	3

CC BY NC 2024 Illustrative Mathematics®

4	5
6	7
8	9

CC BY NC 2024 Illustrative Mathematics®

0	0
10	10

CC BY NC 2024 Illustrative Mathematics®

Directions:

- Remove the cards that show 10. Set them aside.
- Each partner:
  - Take 6 cards.
  - Choose 4 cards to make a multiplication expression. You can multiply a 1-digit number by a 3-digit number or a 2-digit number by a 2-digit number.
  - Write an equation to show the product of the numbers you made.
  - Your score for each round is the difference between your product and 3,000.
- Take new cards so that you have 6 cards to start the next round.
- Add your score for each round. The partner with the lower score wins.

round	multiplication equation	points
1		
2		
3		
4		
5		
6		
7		
8		

1	2
3	4
5	6

CC BY NC 2024 Illustrative Mathematics®

7	8
9	1
2	3

CC BY NC 2024 Illustrative Mathematics®

4	5
6	7
8	9

CC BY NC 2024 Illustrative Mathematics®

0	0
10	10

1	2
3	4
5	6

CC BY NC 2024 Illustrative Mathematics®

7	8
9	1
2	3

4	5
6	7
8	9

0	0
10	10

Directions:

- Remove the cards that show 10. Set them aside.
- Each partner:
  - Take 6 cards.
  - Choose 3 cards to make a multiplication expression with a fraction and a whole number.
  - Write an equation to show the product of the numbers you made.
  - Your score for each round is the difference between your product and 5.
- Take new cards so that you have 6 cards to start the next round.
- Add your score for each round. The partner with the lower score wins.

round	multiplication expression	points
1	$\frac{\square}{\square} \times \square = _____$	
2	$\frac{\square}{\square} \times \square = _____$	
3	$\frac{\square}{\square} \times \square = _____$	
4	$\frac{\square}{\square} \times \square = _____$	

5	$\frac{\square}{\square} \times \square = \underline{\quad\quad}$	
6	$\frac{\square}{\square} \times \square = \underline{\quad\quad}$	
7	$\frac{\square}{\square} \times \square = \underline{\quad\quad}$	
8	$\frac{\square}{\square} \times \square = \underline{\quad\quad}$	

Directions:

- Remove the cards that show 10. Set them aside.
- Each partner:
  - Take 6 cards.
  - Choose 3–4 cards to make an addition expression.
  - Write an equation to show the sum of the numbers you made.
  - Your score for each round is the difference between your sum and 1.
- Take new cards so that you have 6 cards to start the next round.
- Add your score for each round. The partner with the lower score wins.

round	addition equation	points for the round
1	0.___ ___ + 0.___ ___ = _____	
2	0.___ ___ + 0.___ ___ = _____	
3	0.___ ___ + 0.___ ___ = _____	
4	0.___ ___ + 0.___ ___ = _____	
5	0.___ ___ + 0.___ ___ = _____	
6	0.___ ___ + 0.___ ___ = _____	
7	0.___ ___ + 0.___ ___ = _____	
8	0.___ ___ + 0.___ ___ = _____	

CC BY NC 2024 Illustrative Mathematics®

1	2
3	4
5	6

CC BY NC 2024 Illustrative Mathematics®

7	8
9	1
2	3

CC BY NC 2024 Illustrative Mathematics®

4	5
6	7
8	9

CC BY NC 2024 Illustrative Mathematics®

0	0
10	10

1	2
3	4
5	6

CC BY NC 2024 Illustrative Mathematics®

7	8
9	1
2	3

4	5
6	7
8	9

CC BY NC 2024 Illustrative Mathematics®

0	0
10	10

Directions:

- Remove the cards that show 10. Set them aside.
- Each partner:
  - Take 6 cards.
  - Choose 4 cards to make an addition expression.
  - Write an equation to show the sum of the numbers you made.
  - Your score for each round is the difference between your sum and 5.
- Take new cards so that you have 6 cards to start the next round.
- Add your score for each round. The partner with the lower score wins.

round	addition equation	points for the round
1	$\frac{\square}{\square} + \frac{\square}{\square} = _____$	
2	$\frac{\square}{\square} + \frac{\square}{\square} = _____$	
3	$\frac{\square}{\square} + \frac{\square}{\square} = _____$	

4	$\frac{\square}{\square} + \frac{\square}{\square} =$ _____	
5	$\frac{\square}{\square} + \frac{\square}{\square} =$ _____	
6	$\frac{\square}{\square} + \frac{\square}{\square} =$ _____	
7	$\frac{\square}{\square} + \frac{\square}{\square} =$ _____	
8	$\frac{\square}{\square} + \frac{\square}{\square} =$ _____	