# Explore Expressions and Sums

Let's write addition expressions and find the sum of 2 numbers.

Activity 1

# Matching Dot Cards and Expressions

Match each pair of dots to an expression. Then find the total.

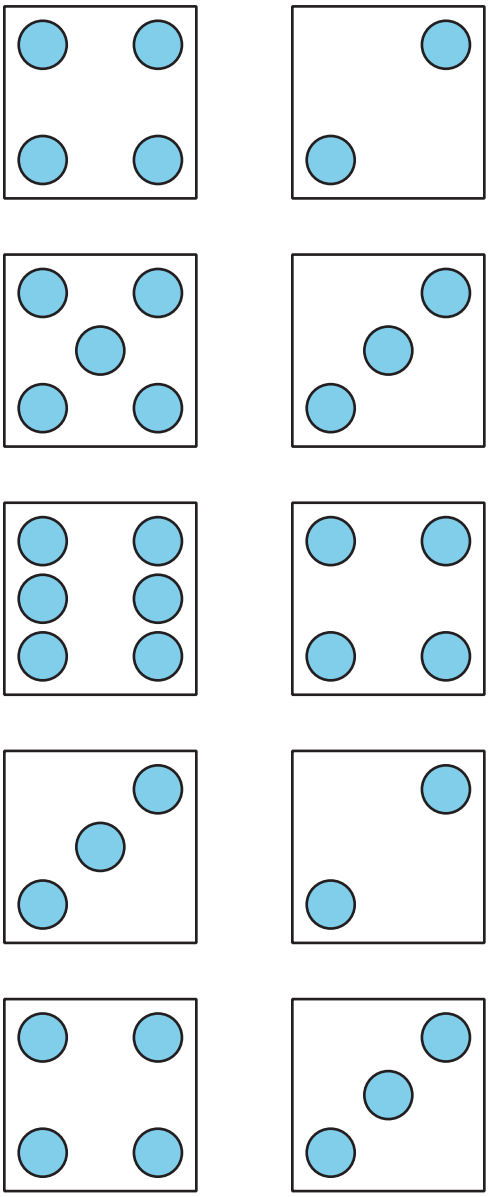

| expression | total |
|---|---|
| $3 + 2$ | |
| $4 + 2$ | |
| $5 + 3$ | |
| $6 + 4$ | |
| $4 + 3$ | |

Draw the missing dots to match the expression. Then find the total.

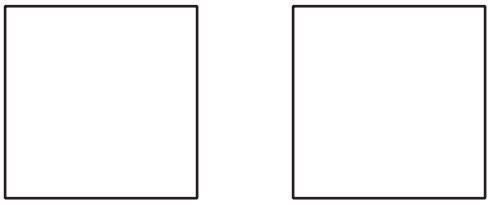

Expression: $4 + 2$

Total: _____

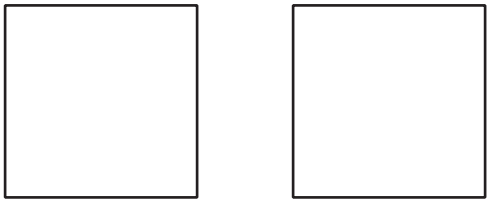

Expression: $5 + 2$

Total: _____

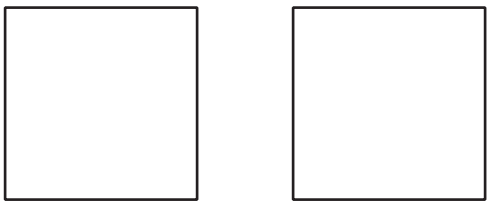

Expression: $2 + 6$

Total: _____

Write the missing expression to match the dots. Then find the total.

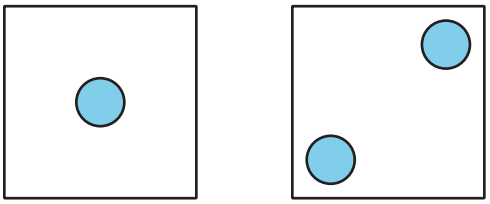

Expression: _____

Total: _____

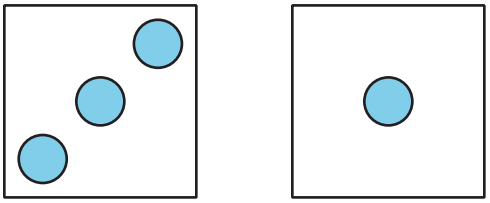

Expression: _____

Total: _____